5. Takmičenje "Kornelije" 2018.

Teorija muzike

IIIa kategorija
I grupa

Ime i prezime učenika

1. Napišite tačne predznake da bi melodija bila u g-mol-u harmonskom:



(4 x 2,5)

Ukupno:

(10)

2. Odredi vrstu tetrahorda:

a)





--- --- ---
(3+3)

b) Napiši tetrahorde naviše od zadatih tonova:

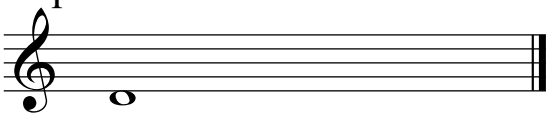

frigijski

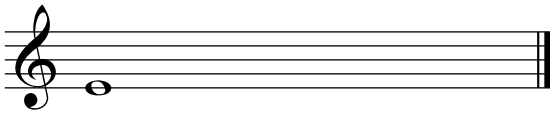

durski

(3+3)

Ukupno:

(12)

3. a) Izgradi intervale na zadatim tonovima:

a)



Č5↓ M2↑ V7↑ Č4↓ M3↑ V6↑

(6x2)

b) prepoznaj intervale i napiši šifru:



(6x2)

--- --- --- --- --- ---

Ukupno:

(24)

4. Napiši trozvuke od zadatih tonova:



(8 x 2,5)

Ukupno:

(20)

5. Napiši hromatski znak ispred nota, da bi akord bio tačan:



(4 x 2,5)

Ukupno:

(10)

6. Pronađi grešku u ritmu i obeleži zvezdicom:



(4 x 3)

Ukupno:

(12)

7. Odgovori sa tačno (T) ili netačno (N):

a) „Piano" znači „tiho". .....

b) „Legato" znači „kratko". .....

v) „Crescendo" znači „postepeno utišavati". .....

g) Gornji tetrahord As dura je Es-F-G-As. .....

d) Postoje male i velike kvarte. .....

đ) Obrtaj V3 je M6. .....

(6 x 2)

Ukupno:

(12)

Komisija: 1.----------

2.----------

3.----------

Ukupno:

(100)